# Creating Rectangles with a Coordinate Grid

Name:

**Find the coordinates of point D to make a rectangle.**

**Ex)**

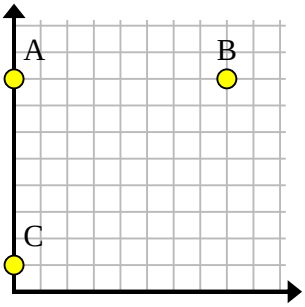


**1)**

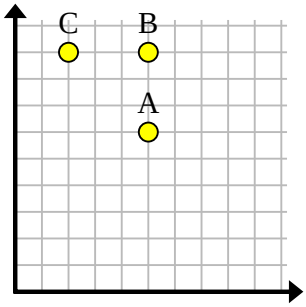


**2)**

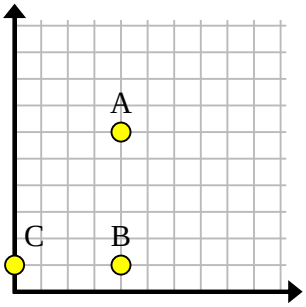


**3)**

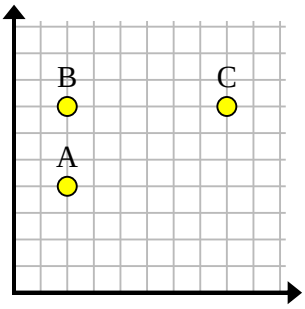


**4)**

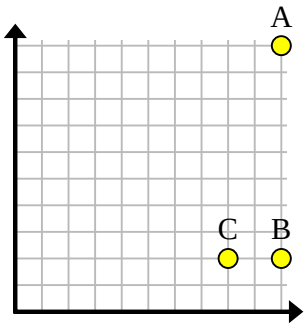


**5)**

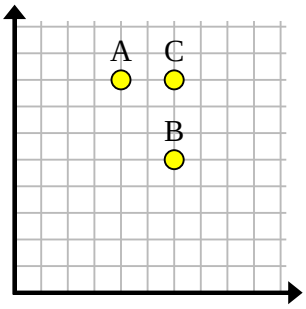


**6)**

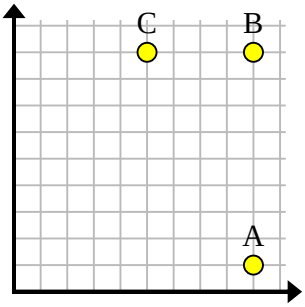


**7)**

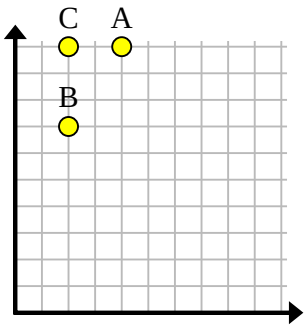


**8)**

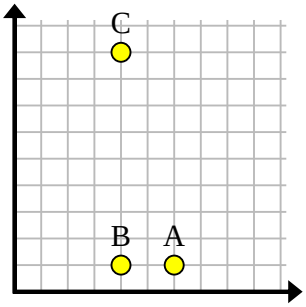


**9)**

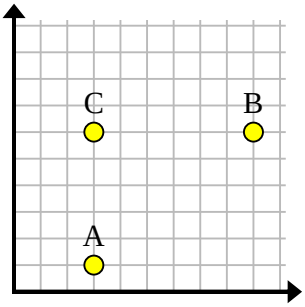


**10)**

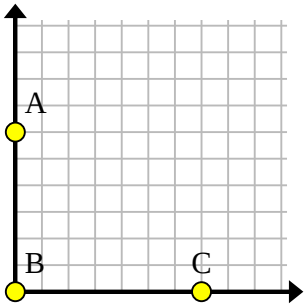


**11)**

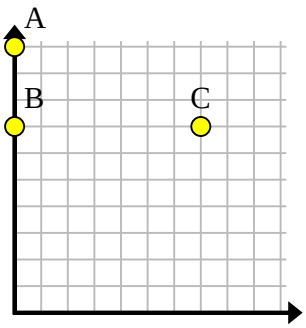


## Answers

Ex. ( 8 , 1 )

1. _____

2. _____

3. _____

4. _____

5. _____

6. _____

7. _____

8. _____

9. _____

10. _____

11. _____



| | | | | | | | | | | |
|---|---|---|---|---|---|---|---|---|---|---|
| 1-10 | 91 | 82 | 73 | 64 | 55 | 45 | 36 | 27 | 18 | 9 |
| 11 | 0 | | | | | | | | | |

Creating Rectangles with a Coordinate Grid Name: **Answer Key**

**Find the coordinates of point D to make a rectangle.**

**Ex)**

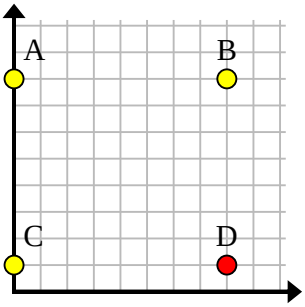


**1)**

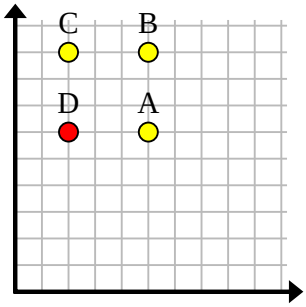


**2)**

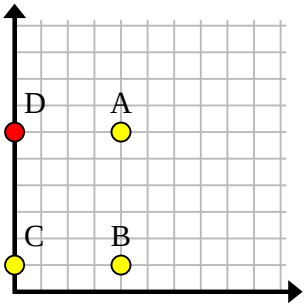


**3)**

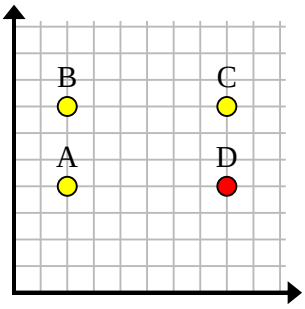


**4)**

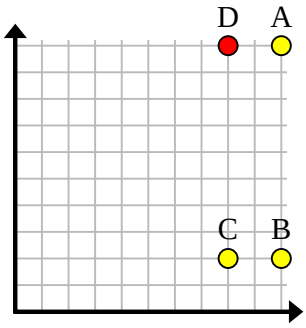


**5)**

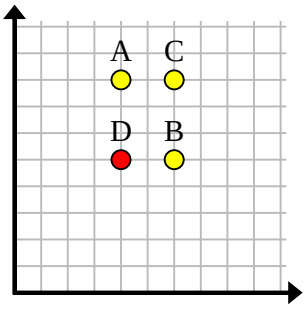


**6)**

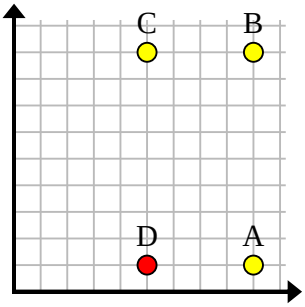


**7)**

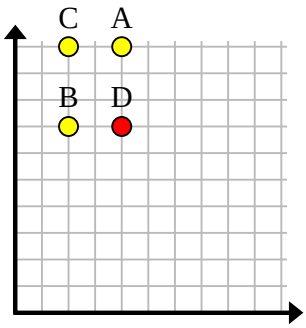


**8)**

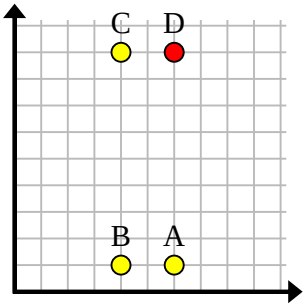


**9)**

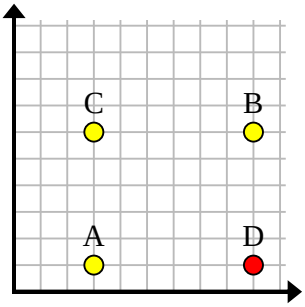


**10)**

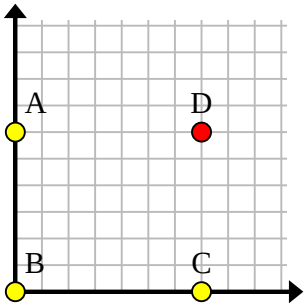


**11)**

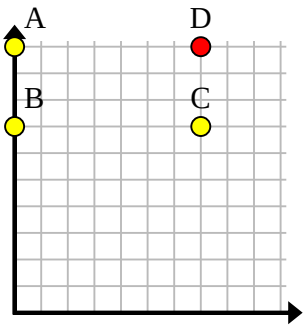


## Answers

| | |
|---|---|
| Ex. | (8, 1) |
| 1. | (2, 6) |
| 2. | (0, 6) |
| 3. | (8, 4) |
| 4. | (8, 10) |
| 5. | (4, 5) |
| 6. | (5, 1) |
| 7. | (4, 7) |
| 8. | (6, 9) |
| 9. | (9, 1) |
| 10. | (7, 6) |
| 11. | (7, 10) |



| | | | | | | | | | | |
|---|---|---|---|---|---|---|---|---|---|---|
| 1-10 | 91 | 82 | 73 | 64 | 55 | 45 | 36 | 27 | 18 | 9 |
| 11 | 0 | | | | | | | | | |